2. Sınıf

Saat Okuma

Adı Soyadı: _____ Sınıfı: _____ Numarası: ____ Tarih: _____

SAATLERİN KAÇI GÖSTERDİĞİNİ YAZINIZ.

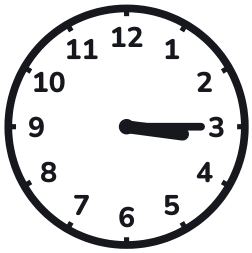
_____


_____


_____


_____


_____


_____


_____


_____


_____

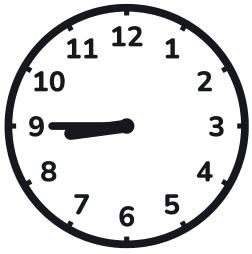
_____


_____


_____


_____


_____


_____


_____

2. Sınıf

Saat Okuma

Adı Soyadı: _____ Sınıfı: _____ Numarası: ____ Tarih: _____

VERİLEN SAATLERİ AKREP VE YELKOVANI ÇİZEREK GÖSTERİNİZ.

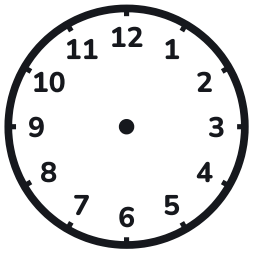

2:30

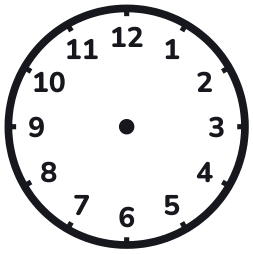

9:30

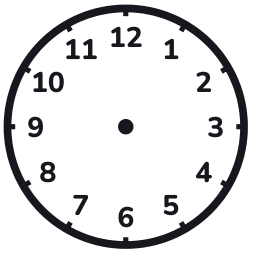

1:30

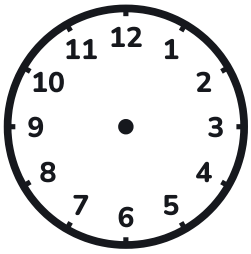

6:00

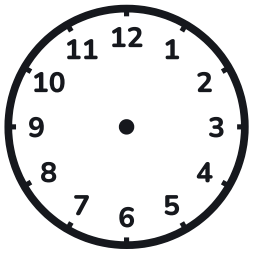

2:00

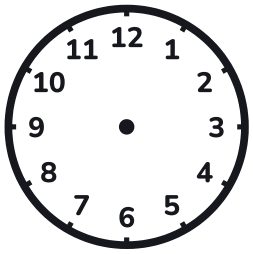

5:30

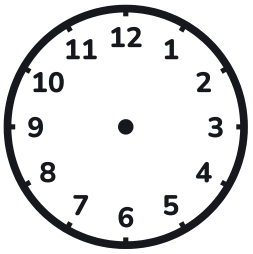

5:00

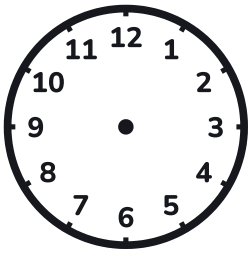

4:30

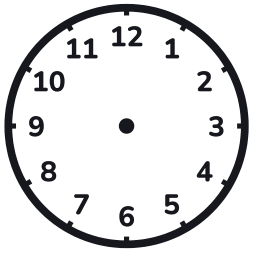

3:00

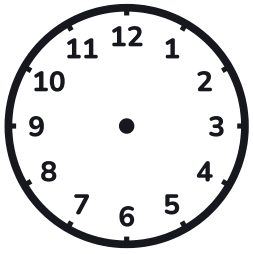

4:30

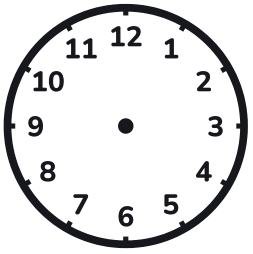

12:00

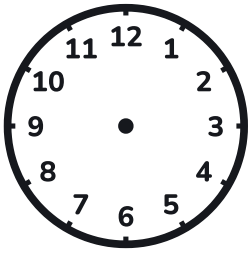

7:30

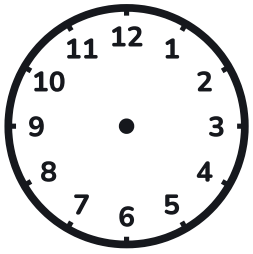

4:00

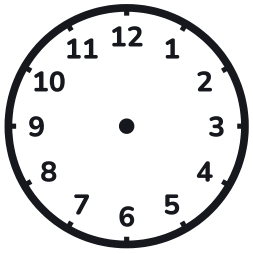

11:00

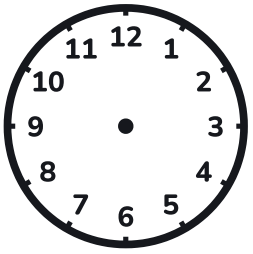

6:00

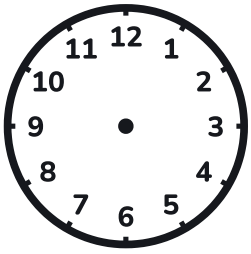

2:00

2. Sınıf

Saat Okuma – Cevap Anahtarı

Adı Soyadı: _____ Sınıfı: _____ Numarası: ____ Tarih: _____

SAATLERİN KAÇI GÖSTERDİĞİNİ YAZINIZ.

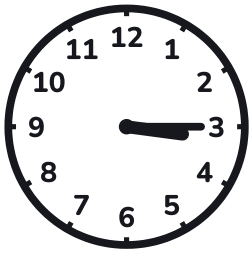

3:15



5:15



12:00



11:30



7:00



7:30



1:15



7:00

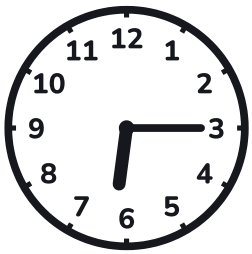

6:15

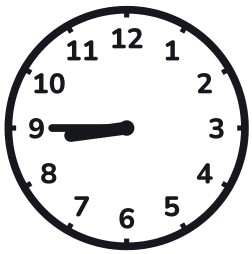

8:45



12:15



3:30



1:30



8:15



10:00



2:00

2. Sınıf

Saat Okuma – Cevap Anahtarı

Adı Soyadı: _____ Sınıfı: _____ Numarası: ____ Tarih: _____

VERİLEN SAATLERİ AKREP VE YELKOVANI ÇİZEREK GÖSTERİNİZ.



2:30



9:30



1:30

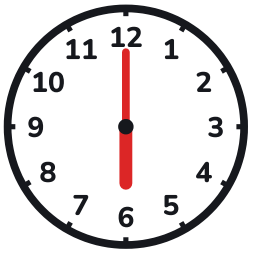

6:00



2:00



5:30

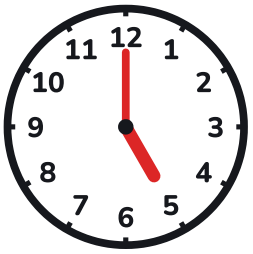

5:00



4:30

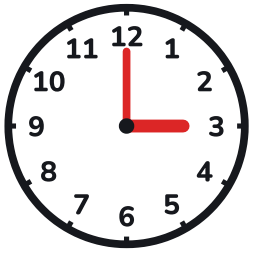

3:00



4:30

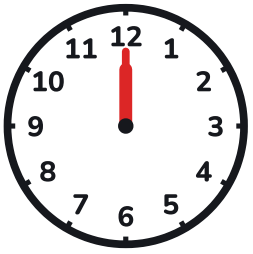

12:00



7:30



4:00



11:00

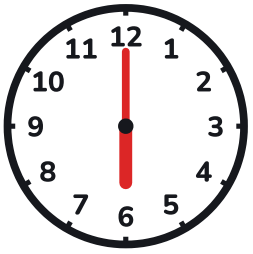

6:00



2:00