Kesirler

Adı Soyadı: ..... Sınıfı: ..... Numarası: ..... Tarih: .....

A. Boyalı kısımları kesirle gösteriniz.







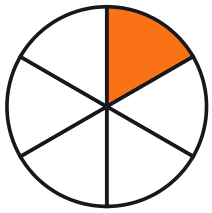

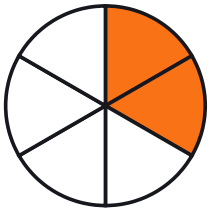

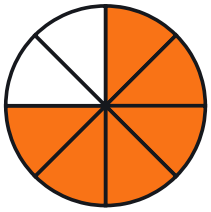

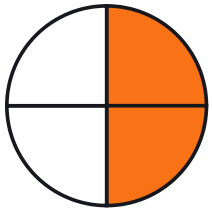









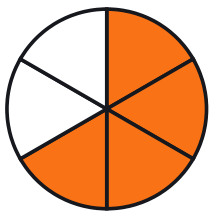

Doğru: _____ Yanlış: _____

ogrenoyna.com

Kesirleri Boyama

Adı Soyadı: ..... Sınıfı: ..... Numarası: ..... Tarih: .....

A. Verilen kesir kadar boyayınız.



$\frac{4}{8}$



$\frac{1}{4}$



$\frac{1}{7}$



$\frac{3}{5}$



$\frac{1}{3}$



$\frac{3}{6}$



$\frac{1}{2}$



$\frac{1}{3}$



$\frac{2}{3}$



$\frac{2}{3}$



$\frac{1}{2}$



$\frac{3}{7}$



$\frac{1}{2}$



$\frac{2}{4}$



$\frac{1}{5}$



$\frac{4}{7}$

Doğru: _____ Yanlış: _____

ogrenoyna.com

Kesirler – Cevap Anahtarı

Adı Soyadı: ..... Sınıfı: ..... Numarası: ..... Tarih: .....

A. Boyalı kısımları kesirle gösteriniz.



$\frac{2}{3}$



$\frac{2}{6}$



$\frac{3}{5}$

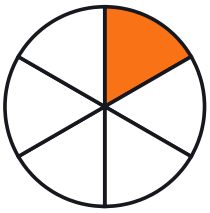

$\frac{1}{6}$

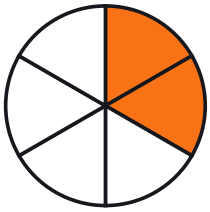

$\frac{2}{6}$

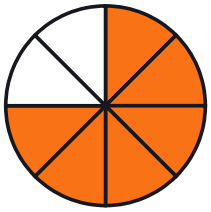

$\frac{6}{8}$

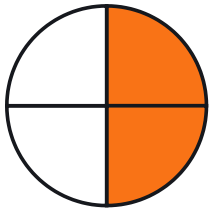

$\frac{2}{4}$



$\frac{1}{3}$



$\frac{1}{3}$



$\frac{2}{7}$



$\frac{6}{8}$

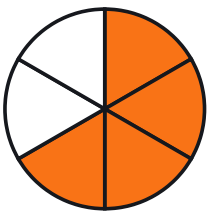

$\frac{4}{6}$

Doğru: _____ Yanlış: _____

ogrenoyna.com

Kesirleri Boyama – Cevap Anahtarı

Adı Soyadı: ..... Sınıfı: ..... Numarası: ..... Tarih: .....

A. Verilen kesir kadar boyayınız.

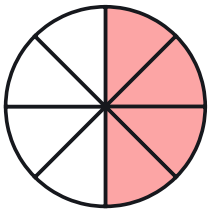

$\frac{4}{8}$

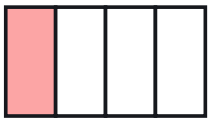

$\frac{1}{4}$



$\frac{1}{7}$

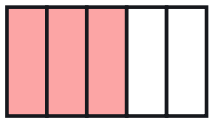

$\frac{3}{5}$

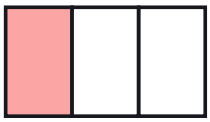

$\frac{1}{3}$

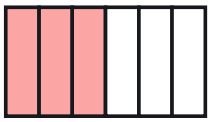

$\frac{3}{6}$

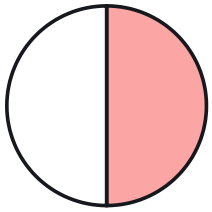

$\frac{1}{2}$

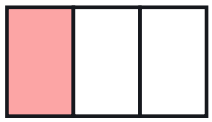

$\frac{1}{3}$

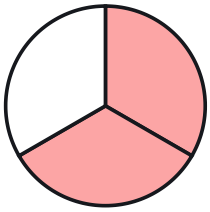

$\frac{2}{3}$

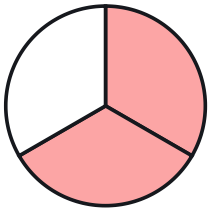

$\frac{2}{3}$

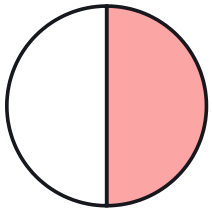

$\frac{1}{2}$

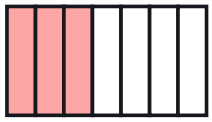

$\frac{3}{7}$

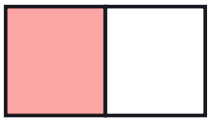

$\frac{1}{2}$

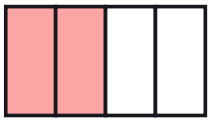

$\frac{2}{4}$

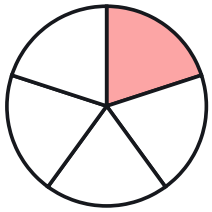

$\frac{1}{5}$

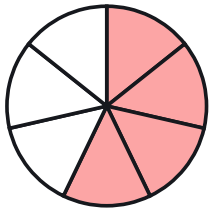

$\frac{4}{7}$

Doğru: _____ Yanlış: _____

ogrenoyna.com